Name : _____ Score : _____

Teacher : _____ Date : _____

Find the Ratios



What is the ratio of ▲ to □ ? = ____ : ____ = ____ : ____

What is the ratio of □ to (▲ + □) ? = ____ : ____ = ____ : ____



What is the ratio of ☆ to ■ ? = ____ : ____ = ____ : ____

What is the ratio of ■ to (☆ + ■) ? = ____ : ____ = ____ : ____



What is the ratio of ■ to ◆ ? = ____ : ____ = ____ : ____

What is the ratio of ◆ to (■ + ◆) ? = ____ : ____ = ____ : ____



What is the ratio of ● to ■ ? = ____ : ____ = ____ : ____

What is the ratio of ■ to (● + ■) ? = ____ : ____ = ____ : ____

Name : _____ Score : _____

Teacher : _____ Date : _____

Find the Ratios

= 24 : 16 = 3 : 2

= 16 : 40 = 2 : 5

= 36 : 48 = 3 : 4

= 48 : 84 = 4 : 7

= 24 : 40 = 3 : 5

= 40 : 64 = 5 : 8

= 63 : 35 = 9 : 5

= 35 : 98 = 5 : 14

Math-Aids.Com